Q1. Chromatography is used to identify amino acid sequences in compounds.

The dipeptide cysteine-aspartic acid (cys-asp), **J**, and the dipeptide aspartic acid-cysteine (asp-cys), **K**, are shown.

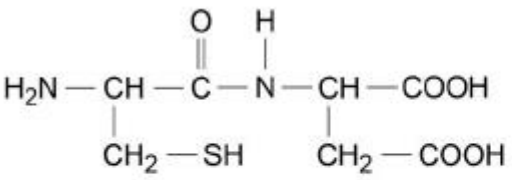

J (cys–asp)

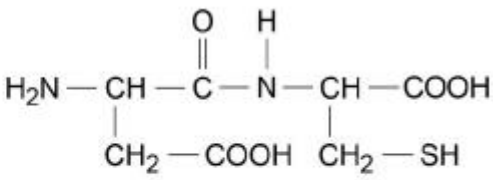

K (asp–cys)

(a) A mixture of the two dipeptides **J** and **K** is analysed by gas chromatography followed by mass spectrometry (GC-MS).

Explain why **J** and **K** can be separated by gas chromatography and why mass spectrometry using electrospray ionisation does **not** enable you to identify them.

Gas chromatography explanation _____

_____

_____

_____

_____

_____

_____

Mass spectrometry explanation _____

_____

_____

_____

_____

_____

_____

_____

(4)

(b) A tripeptide, **L**, is partially hydrolysed with concentrated hydrochloric acid to produce two dipeptides and the amino acids alanine (ala), lysine (lys) and serine (ser).

The two dipeptides are separated by chromatography. The diagram below shows the chromatogram.

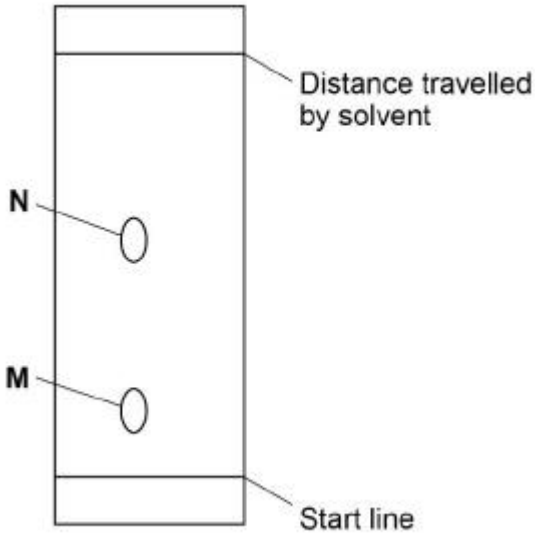

The table below contains the R_f values of some dipeptides.

Dipeptide	ala-lys	ala-ser	lys-ser	lys-ala	ser-ala	ser-lys
R_f value	0.55	0.85	0.10	0.20	0.15	0.45

Use the chromatogram in the diagram above and the R_f values in the table to identify the two dipeptides present in spots **M** and **N**.

Use your answers to deduce the order of the amino acids in the tripeptide **L**.

Dipeptide responsible for spot **M** _____

_____

Dipeptide responsible for spot **N** _____

_____

Order of amino acids in tripeptide **L** _____

_____

(3)
(Total 7 marks)

Q2. (a) A chemist discovered four unlabelled bottles of liquid, each of which contained a different pure organic compound. The compounds were known to be propan-1-ol, propanal, propanoic acid and 1-chloropropane.

Describe four **different** test-tube reactions, one for each compound, that could be used to identify the four organic compounds.
Your answer should include the name of the organic compound, the reagent(s) used and the expected observation for each test.

_____

_____

_____

_____

_____

_____

_____

_____

_____

_____

_____

_____

_____

(Extra space) _____

_____

_____

_____

(8)

(b) A fifth bottle was discovered labelled propan-2-ol. The chemist showed, using infrared spectroscopy, that the propan-2-ol was contaminated with propanone.

The chemist separated the two compounds using column chromatography. The column contained silica gel, a polar stationary phase.

The contaminated propan-2-ol was dissolved in hexane and poured into the column. Pure hexane was added slowly to the top of the column. Samples of the eluent (the solution leaving the bottom of the column) were collected.

- Suggest the chemical process that would cause a sample of propan-2-ol to become contaminated with propanone.
- State how the infrared spectrum showed the presence of propanone.
- Suggest why propanone was present in samples of the eluent collected first (those with shorter retention times), whereas samples containing propan-2-ol were collected later.

_____

_____

_____

_____

_____

_____

_____

_____

_____

(Extra space) _____

_____

_____

_____

_____

_____

_____

_____

(4)

(Total 12 marks)

Q3.

This question is about nitrobenzenes.

(a) Nitrobenzene reacts when heated with a mixture of concentrated nitric acid and concentrated sulfuric acid to form a mixture of three isomeric dinitrobenzenes.

Write an equation for the reaction of concentrated nitric acid with concentrated sulfuric acid to form the species that reacts with nitrobenzene.

_____

(1)

(b) Name and outline a mechanism for the reaction of this species with nitrobenzene to form 1,3-dinitrobenzene.

Name of mechanism

_____

Mechanism

(4)

(c) The dinitrobenzenes shown were investigated by thin layer chromatography (TLC).

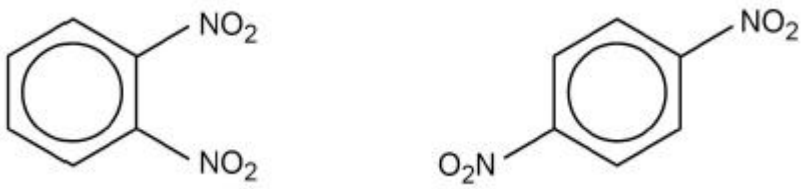

In an experiment, carried out in a fume cupboard, a concentrated solution of pure 1,4-dinitrobenzene was spotted on a TLC plate coated with a solid that contains polar bonds. Hexane was used as the solvent in a beaker with a lid.

The start line, drawn in pencil, the final position of the spot and the final solvent front are shown on the chromatogram in the diagram below



Use the chromatogram in the diagram above to deduce the R^f value of 1,4-dinitrobenzene in this experiment.

Tick (✓) **one** box.

A 0.41 ☐

B 0.46 ☐

C 0.52 ⬭

D 0.62 ⬭

(1)

(d) State in general terms what determines the distance travelled by a spot in TLC.

_____

(1)

(e) To obtain the chromatogram, the TLC plate was held by the edges and placed in the solvent in the beaker in the fume cupboard. The lid was then replaced on the beaker.

Give one other practical requirement when placing the plate in the beaker.

_____

(1)

(f) A second TLC experiment was carried out using 1,2- dinitrobenzene and 1,4-dinitrobenzene. An identical plate to that in part (c) was used under the same conditions with the same solvent. In this experiment, the Rf value of 1,4-dinitrobenzene was found to be greater than that of 1,2- dinitrobenzene.

Deduce the relative polarities of the 1,2- dinitrobenzene and 1,4- dinitrobenzene and explain why 1,4- dinitrobenzene has the greater R_f value.

Relative polarities

_____

Explanation

_____

_____

_____

(2)

(g) A third TLC experiment was carried out using 1,2- dinitrobenzene. An identical plate to that in part (c) was used under the same conditions, but the solvent used contained a mixture of hexane and ethyl ethanoate.

A student stated that the R_f value of 1,2- dinitrobenzene in this third experiment would be greater than that of 1,2- dinitrobenzene in the experiment in part (f)

Is the student correct? Justify your answer.

_____

_____

_____

_____

(2)

(Total 12 marks)

Q4. (a) Name compound **Y**, $HOCH_2CH_2COOH$

_____

(1)

(b) Under suitable conditions, molecules of **Y** can react with each other to form a polymer.

(i) Draw a section of the polymer showing **two** repeating units.

(1)

(ii) Name the type of polymerisation involved.

_____

(1)

(c) When **Y** is heated, an elimination reaction occurs in which one molecule of **Y** loses one molecule of water. The organic product formed by this reaction has an absorption at 1637 cm^{-1} in its infrared spectrum.

(i) Identify the bond that causes the absorption at 1637 cm^{-1} in its infrared spectrum.

_____

(1)

(ii) Write the displayed formula for the organic product of this elimination reaction.

(1)

(iii) The organic product from part (ii) can also be polymerised.
Draw the repeating unit of the polymer formed from this organic product.

(1)

(d) At room temperature, 2-aminobutanoic acid exists as a solid.
Draw the structure of the species present in the solid form.

(1)

(e) The amino acid, glutamic acid, is shown below.

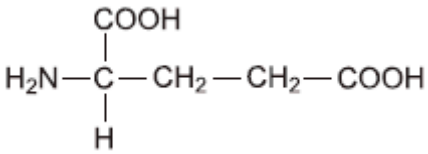

Draw the structure of the organic species formed when glutamic acid reacts with each of the following.

(i) an excess of sodium hydroxide

(1)

(ii) an excess of methanol in the presence of concentrated sulfuric acid

(1)

(iii) ethanoyl chloride

(1)

(f) A tripeptide was heated with hydrochloric acid and a mixture of amino acids was

formed. This mixture was separated by column chromatography.
Outline briefly why chromatography is able to separate a mixture of compounds.
Practical details are **not** required.

_____

_____

_____

_____

(3)

(Total 13 marks)

Q5. Lysine and alanine are two amino acids.

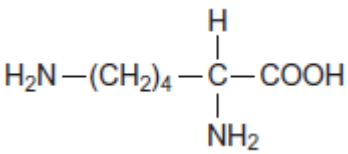

lysine

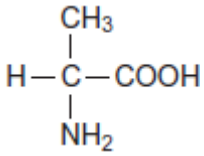

alanine

(a) Give the IUPAC name of lysine.

_____

(1)

(b) Draw structures to show the product formed in each case when lysine reacts with

(i) an excess of aqueous HCl

(1)

(ii) an excess of aqueous NaOH

(1)

(iii) methanol in the presence of a small amount of concentrated H_2SO_4

(1)

(c) The mass spectrum of alanine gives a major peak at $m / z = 44$

Write an equation for the fragmentation of the molecular ion of alanine to give an ion that produces this peak.
In your answer, draw the displayed formula for this fragment ion.

(2)

(d) Draw a dipeptide formed from one molecule of lysine and one molecule of alanine.

(1)

(e) The dipeptide in part (d) is hydrolysed in acid conditions and the mixture produced is analysed by column chromatography. The column is packed with a resin which acts as a polar stationary phase.

Suggest why lysine leaves the column after alanine.

_____

_____

_____

_____

(2)
(Total 9 marks)

Q6. A peptide is hydrolysed to form a solution containing a mixture of amino acids. This mixture is then analysed by silica gel thin-layer chromatography (TLC) using a toxic solvent. The individual amino acids are identified from their R_f values.

Part of the practical procedure is given below.

1. **Wearing plastic gloves to hold a TLC plate**, draw a pencil line 1.5 cm from the bottom of the plate.
2. Use a capillary tube to apply a very small drop of the solution of amino acids to the mid-point of the pencil line.
3. Allow the spot to dry completely.
4. In the developing tank, add the developing solvent to **a depth of not more than 1 cm**.
5. Place your TLC plate in the developing tank.
6. Allow the developing solvent to rise up the plate **to the top**.
7. Remove the plate and quickly mark the position of the solvent front with a pencil.
8. Allow the plate to dry **in a fume cupboard**.

(a) Parts of the procedure are in bold text.

For each of these parts, consider whether it is essential and justify your answer.

_____

_____

_____

_____

_____

(4)

(b) Outline the steps needed to locate the positions of the amino acids on the TLC plate and to determine their R_f values.

(4)

(c) Explain why different amino acids have different R_f values.

(2)

(Total 10 marks)

Mark schemes

Q1.

(a) **Gas chromatography explanation**

Different retention times / dipeptides appear at different times.

1

Different balance between solubility in the moving phase / gas carrier **and** retention by the stationary phase / column **OR** different relative affinity for mobile and stationary phases.

1

Mass spectrometry explanation

Same *m/z* values.

1

(Both) dipeptides / **J** and **K** have same molecular formula / M_r.

1

(b) ser-ala

1

ala-lys

1

ser-ala-lys

This order only.

1

[7]

Q2.

(a) **If 2 stage test for one compound, award no marks for that compound, eg no mark for ROH or RX to alkene then Br_2 test. If reagent is wrong or missing, no mark for that test; if wrong but close/incomplete, lose reagent mark but can award for correct observation. In each test, penalise each example of wrong chemistry, eg $AgClr_2$**

propan-1-ol

acidified
potassium
dichromate

sodium

Named acid + conc H_2SO_4

named acyl chloride

PCl_5

M1

1

(orange) turns green

effervescence

Sweet smell

Sweet smell /misty fumes

Misty fumes

M2
1

propanal

add Tollens or Fehlings / Benedicts

acidified
potassium
dichromate

Bradys or 2,4-dnph
if dichromate used for alcohol cannot be used for aldehyde

M3
1

Tollens: silver mirror or Fehlings/ Benedicts: red ppt

(orange) turns green

Yellow or orange ppt

M4
1

propanoic acid

Named carbonate/ hydrogencarbonate

water and UI (paper)

Named alcohol + conc H_2SO_4

sodium or magnesium

PCl_5
if sodium used for alcohol cannot be used for acid

M5
1

effervescence

orange/red

Sweet smell

effervescence

Misty fumes

if PCl_5 used for alcohol cannot be used for acid

M6
1

1-chloro propane

NaOH then acidified $AgNO_3$

$AgNO_3$

If acidification missed after NaOH,
no mark here but allow mark for observation

M7
1

white ppt

white ppt

M8
1

(b) oxidation (of alcohol by oxygen in air)

M1
1

absorption at 1680 -1750 (due to C=O)

Must refer to the spectrum

M2
1

comparison of polarity of molecules or correct imf statement:
propanone is less polar OR propan-2-ol is more polar
OR propanone has dipole-dipole forces
OR propan-2-ol has hydrogen bonding

M3
1

about attraction to stationary phase or solubility in moving phase
Propan-2-ol has greater affinity for stationary phase or vice versa
OR propanone is more soluble in solvent/moving phase or vice versa

M4
1

[12]

Q3.

(a) $HNO_3 + 2H_2SO_4 \longrightarrow NO_2^+ + H_3O^+ + 2HSO_4^-$

Allow $H_2SO_4 + HNO_3 \longrightarrow NO_2^+ + HSO_4^- + H_2O$

Allow a combination of equations which produce NO_2^+

Penalise equations which produce SO_4^{2-}

1

(b) Electrophilic substitution.

Ignore nitration

1

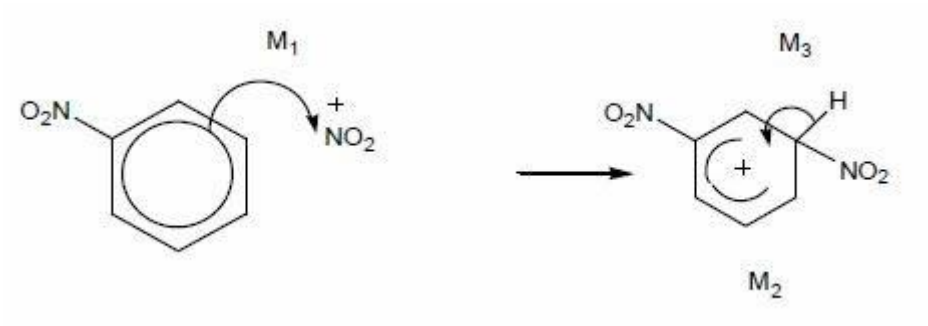

3

OR Kekule

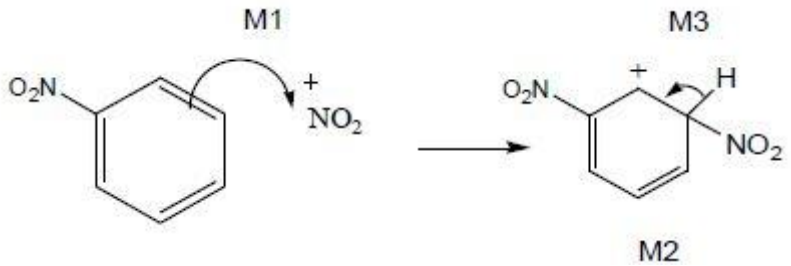

M1 Arrow from inside hexagon to N or + on N (Allow NO_2^+)

M2 Structure of intermediate

- *horseshoe centred on C1 and must not extend beyond C2 and C6, but can be smaller*
- *+ in intermediate not too close to C1 (allow on or "below" a line from C2 to C6)*

M3 Arrow from bond into hexagon (Unless Kekule)

- *Allow M3 arrow independent of M2 structure*
- *+ on H in intermediate loses M2 not M3*

(c) D

1

(d) (Balance between) solubility in moving phase and retention by stationary phase

OR (relative) affinity for stationary / solid and mobile / liquid / solvent (phase)

(e) Solvent depth must be below start line

Ignore safety

1

(f) 1,2- is more polar **OR** 1,4- is less polar
OR 1,2 is polar, 1,4- is non-polar

1

1,4- (or Less/non polar is) less attracted to (polar) plate / stationary phase / solid
OR (Less/non polar is) more attracted to / more soluble in (non-polar) solvent / mobile phase / hexane

1

M2 dependent on correct M1
If M1 is blank then read explanation for possible M1 and M2
Allow converse argument for 1,2

(g) No CE = 0

Yes - mark on but there is **NO MARK FOR YES**
Mark independently following yes

Solvent (more) polar or ethyl ethanoate is polar

1

Polar isomer more attracted to / more soluble in / stronger affinity to the solvent (than before)
Penalise bonded to mobile phase in M2

1

[12]

Q4.

(a) 3-hydroxypropanoic acid
allow 3-hydroxypropionic acid
must be correct spelling

1

(b) (i) must show trailing bonds

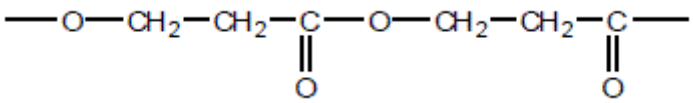

or can start at any point in the sequence, e.g.

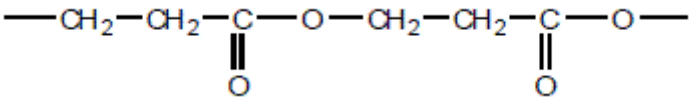

not allow dimer
allow –O–$CH_2CH_2COOCH_2CH_2CO$–
or –$CH_2CH_2COOCH_2CH_2COO$–
ignore ( ) or n
NB answer has a total of 6 carbons and 4 oxygens

1

(ii) condensation (polymerisation)

Allow close spelling

1

(c) (i) C=C or carbon-carbon <u>double</u> bond

1

(ii)

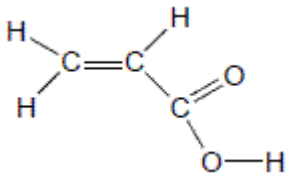

*must show **ALL** bonds including O–H*

1

(iii) must show trailing bonds

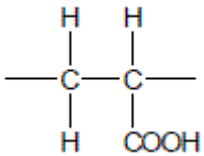

allow polyalkene conseq on their c(ii)

ignore n

1

(d)

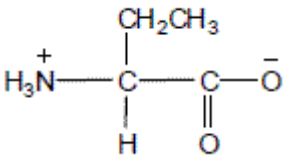

allow NH_3^+—

allow COO^-

1

(e) (i)

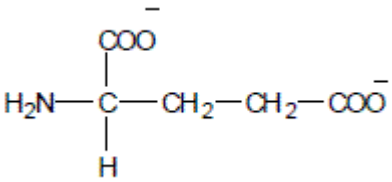

In (e), do not penalise a slip in the number of carbons in the $-CH_2CH_2-$ chain, but all must be bonded correctly

NB two carboxylate groups

Allow COONa or COO^- Na^+ but not covalent bond to Na

allow NH_2–

1

(ii)

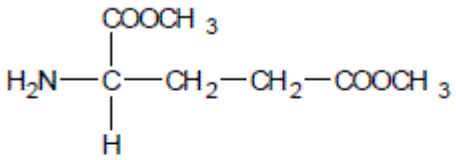

OR

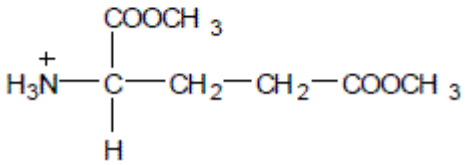

In (e), do not penalise a slip in the number of carbons in the -CH_2CH_2- chain, but all must be bonded correctly

NB two ester groups

allow NH_2– or $^+NH_3$–

1

(iii)

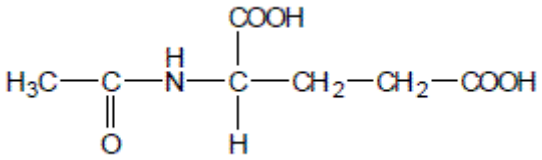

In 4(e), do not penalise a slip in the number of carbons in the -CH_2CH_2- chain, but all must be bonded correctly

allow anhydride formation on either or both COOH groups (see below) with or without amide group formation

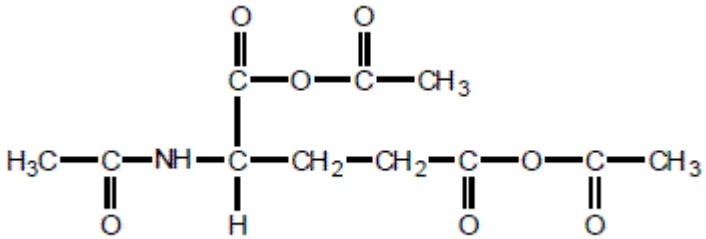

1

(f) **M1** phase or eluent or solvent (or named solvent) is <u>moving or mobile</u>

1

M2 stationary phase or solid or alumina/silica/resin

1

M3 separation depends on balance between solubility or affinity (of compounds) in each phase
OR
different adsorption or retention
OR
(amino acids have) different R_f values
OR
(amino acids) travel at different speeds or take different times

1

[13]

Q5.

(a) <u>2,6-diaminohexanoic acid</u>

Ignore additional , or – or spaces.

1

(b) (i)

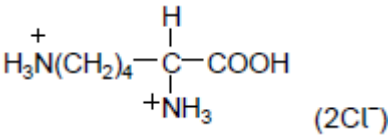

NB both N must be protonated.

Allow $-NH_3^+$ *allow* CO_2H *Allow* $-^+H_3N$.

Penalise – C_4H_8 *– here.*

1

(ii)

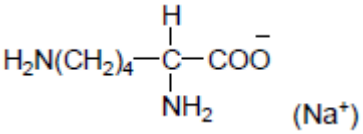

Allow CO_2^-.

Allow $-H_2N$.

Allow –COONa but penalise O–Na bond shown.

1

(iii)

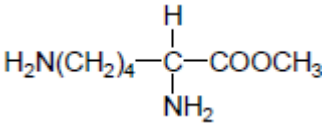

Allow CO_2CH_3.

Allow $-NH_3^+$ *or* $-H_2N$.

1

(c)

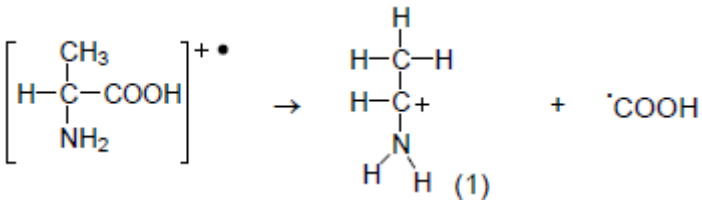

1 for <u>displayed formula</u> of fragment ion.

1 for molecular ion of alanine AND radical.

Allow molecular ion without brackets and fragment ion in brackets with outside +.

Allow dot anywhere on radical.

Allow $[C_3H_7NO_2]^{+\bullet}$ *for molecular ion.*

2

(d)

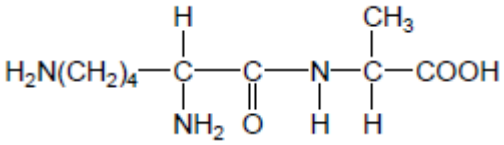

OR

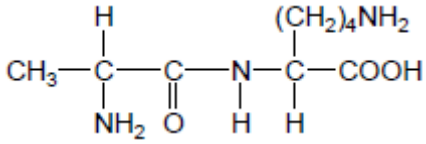

OR

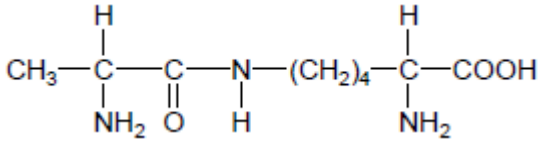

Dipeptide, not repeating unit /.
Allow CO_2H Allow $–H_2N$.
Allow –CONH–.

1

(e) M1 In acid lysine has double positive or more positive charge

1

M2 (Lysine ion) has greater affinity / greater attraction / adheres better / sticks better to polar / stationary phase

M2 only scores after a correct M1.
Ignore greater retention time.

1

[9]

Q6.

(a) **Wear plastic gloves:**

Essential – to prevent contamination from the hands to the plate

1

Add developing solvent to a depth of not more than 1 cm^3:

Essential – if the solvent is too deep it will dissolve the mixture from the plate

1

Allow the solvent to rise up the plate to the top:

Not essential – the R_f value can be calculated if the solvent front does not reach the top of the plate

1

Allow the plate to dry in a fume cupboard:

Essential – the solvent is toxic
Allow hazardous

1

(b) Spray with developing agent or use UV

1

Measure distances from initial pencil line to the spots (*x*)

1

Measure distance from initial pencil line to solvent front line (*y*)

1

R_f value = x / y

1

(c) Amino acids have different polarities

1

Therefore, have different retention on the stationary phase or different solubility in the developing solvent

1

[10]